SKILLS in GEOGRAPHY

Distance and Direction

New South Wales

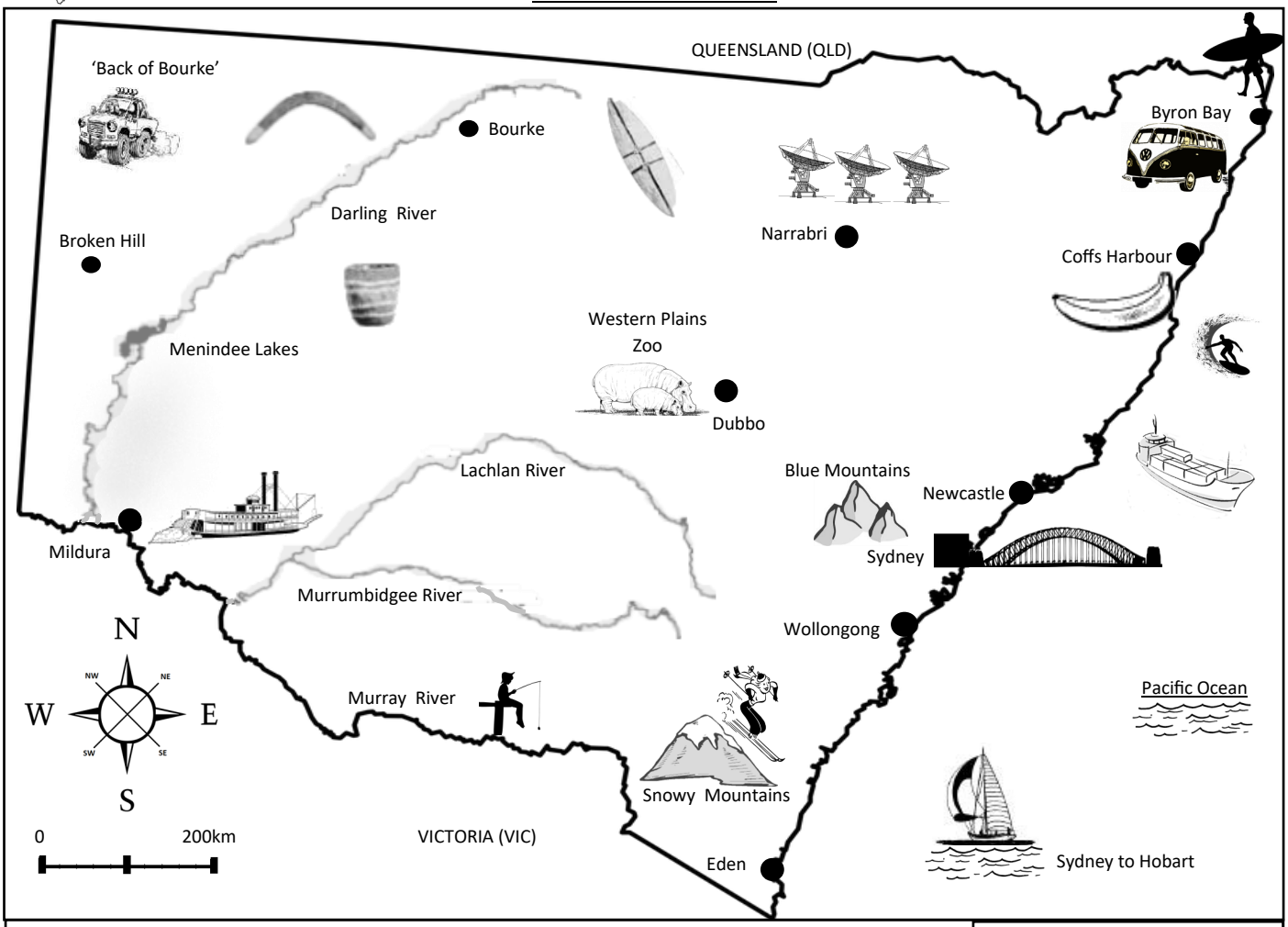

1. Label the 4 point compass provided.

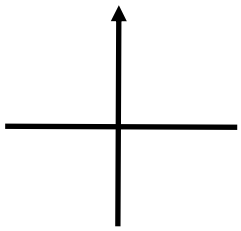
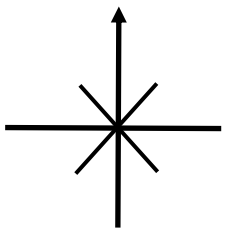
2. What cardinal direction (N,S,E or W) is opposite south? _____
3. In which cardinal direction is Sydney from Mildura? _____
4. Is the distance from Newcastle to Sydney 100 km or 500 km? _____ km
5. Is Sydney 750 km or 7000 km from Byron Bay? _____ km
6. What distance is Sydney from Wollongong? _____ km
7. Approximately, what distance is Broken Hill from Coffs Harbour? _____ km
8. Approximately, how far are the Snowy Mountains from Sydney? _____ km
9. Does the Darling River flow southwest or northwest into the Murray River? _____
10. In what cardinal direction do the Murrumbidgee and Lachlan Rivers flow? _____
11. What is the distance between Sydney and the Blue Mountains? _____ km
12. Does the Murray River flow generally northwest or northeast? _____
13. What is the distance from Coffs Harbour to Byron Bay? _____ km
14. How far is Sydney from the Western Plains Zoo? _____ km
15. Label the 8 point compass provided.